Aşağıda verilen görsellerdeki varlıkların adlarını bulmacadaki yerlerine yazalım.

1


2


3


4
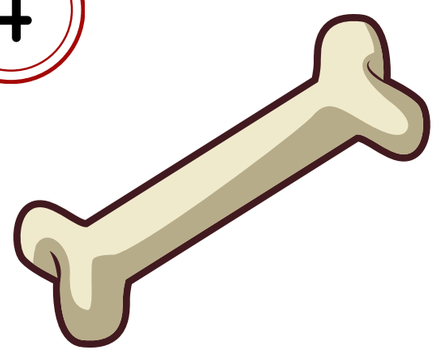

5

6

7


8

9


10

11

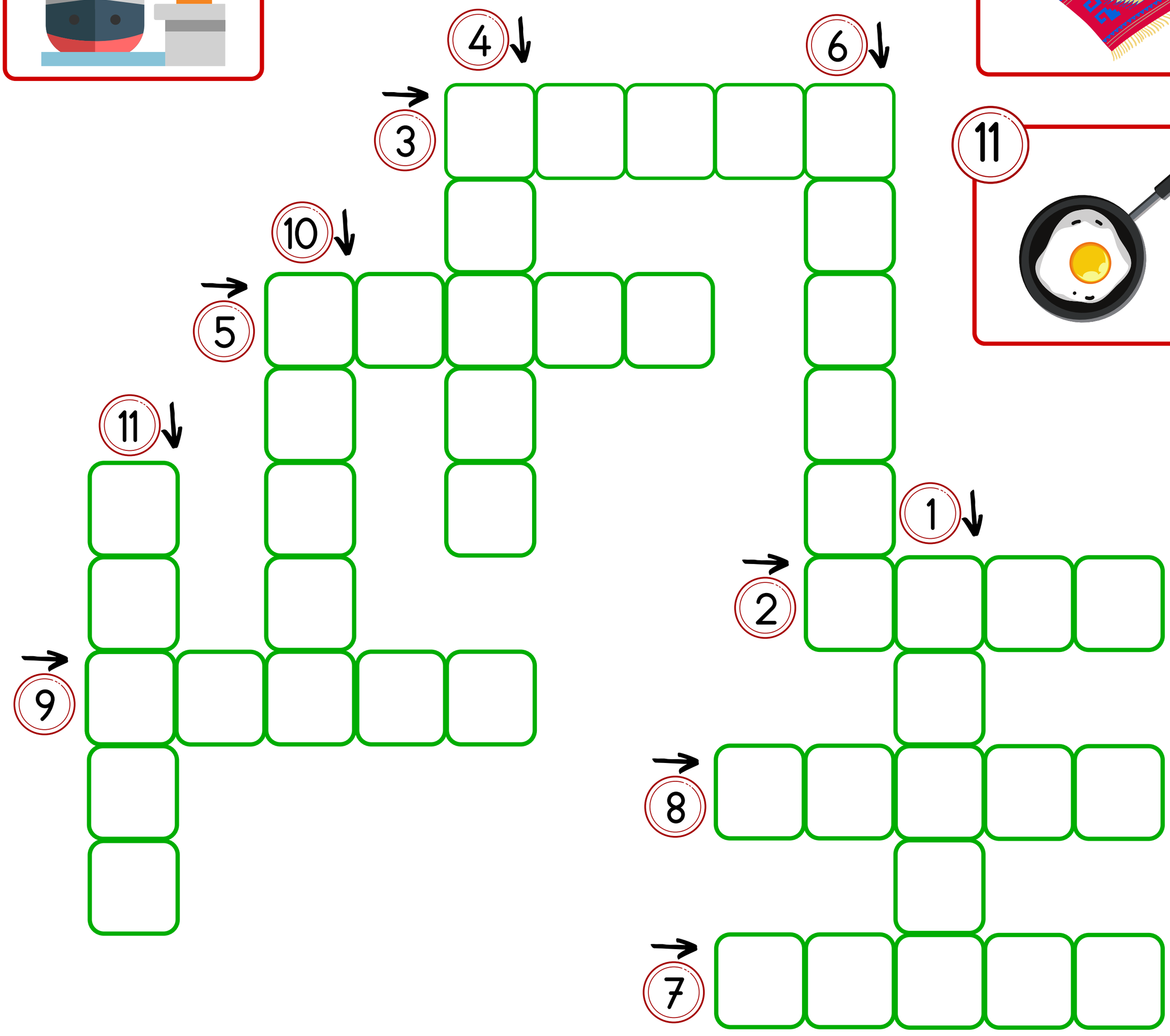

@esra_ogretmenimm

Aşağıda verilen görsellerdeki varlıkların adlarını bulmacadaki yerlerine yazalım.

1

2


3


4
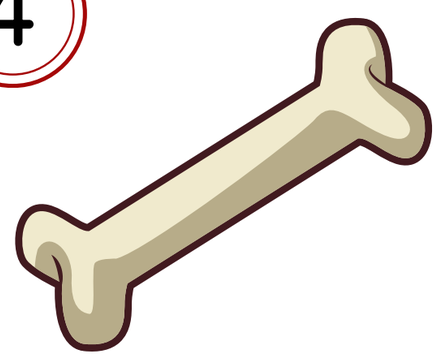

5

6

7


8

9


10

11

						4 ↓			6 ↓	
					3 →	K	A	L	E	M
						E				A
		10 ↓			5 →	K	E	M	A	N
						İ		İ		İ
	11 ↓					L		K		N
	O					İ		İ		
	M									
9 →	L	İ	M	A	N					
	E									
	T									